MHIS 136

Chapter 12, #1 - Linear 6/4 Chords _____

Name

Complete the following figured basses and identify the type of 6/4 chord used in each:



Bb: I V^{6}_{4} I^{6} IV V I V I^{6}_{4} V V^{6} I

Passing Pedal



i V^{6}_{4} i^{6} iv V i I IV^{6} I^{6}_{4} V I

Passing Cad-Tonic

Analyze the following. Identify all 6/4 chord types.



i V^{6}_{4} i^{6} i V^{6} V i iv^{6}_{4} i i^{6} iv $ii^{\circ\,6}$ i^{6}_{4} V i

Passing Pedal Cad-tonic